Finding Part of a Set

1 Circle to divide the objects into two equal groups.
Fill in the blanks.

(a)



$\frac{1}{2}$ of 10 = ☐

(b)



$\frac{1}{2}$ of 18 = ☐

(c)



$\frac{1}{2}$ of 24 = ☐

Finding Part of a Set

1 Circle to divide the objects into three equal groups.
Fill in the blanks.

(a)

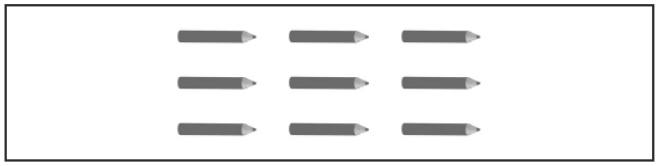

$\frac{1}{3}$ of 9 = ☐

(b)

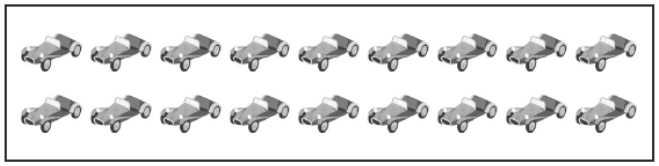

$\frac{1}{3}$ of 18 = ☐

(c)



$\frac{1}{3}$ of 30 = ☐

Finding Part of a Set

1 Circle to divide the objects into four equal groups.
Fill in the blanks.

(a)



$\frac{1}{4}$ of 12 = ☐

(b)



$\frac{1}{4}$ of 16 = ☐ $\frac{2}{4}$ of 16 = ☐

(c)



$\frac{1}{4}$ of 28 = ☐ $\frac{3}{4}$ of 28 = ☐

2 Fill in the blanks.

(a) $\frac{1}{2}$ of 16 cm = ☐ cm

(b) $\frac{1}{2}$ of 30 cm = ☐ cm

(c) $\frac{1}{3}$ of 15 cm = ☐ cm

(d) $\frac{1}{3}$ of 33 cm = ☐ cm

(e) $\frac{2}{3}$ of 18 cm = ☐ cm

(f) $\frac{1}{4}$ of 28 cm = ☐ cm

(g) $\frac{1}{4}$ of 48 cm = ☐ cm

(h) $\frac{2}{4}$ of 20 cm = ☐ cm

(i) $\frac{3}{4}$ of 12 cm = ☐ cm